同じ大きさの立方体４個を貼り合わせた図Ⅰ～Ⅲのような立体を，面Ａと面ａ，面Ｂと面ｂ，面Ｃと面ｃがそれぞれぴったり合わさるように組み合わせ，最後に，同じ立方体を４個貼り合わせた立体をもう一つ組み合わせたところ，直方体になった。このとき，最後に組み合わせた立体はどれか。

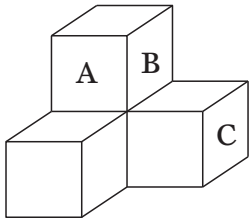

図Ⅰ

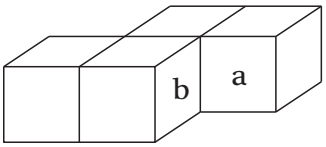

図Ⅱ

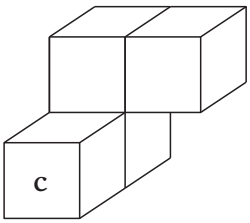

図Ⅲ

1．

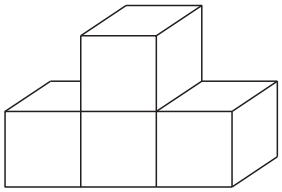

2．

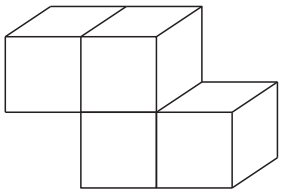

3．

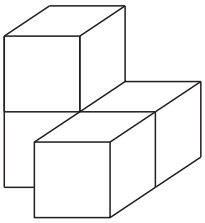

4．

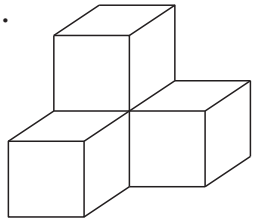
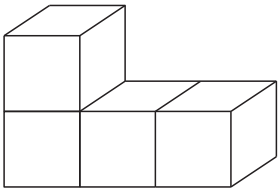
5．